Counting Figures Name:

Count the number of shapes in each box.



Ex) = 6

1) 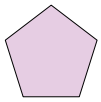 = _____

2) = _____

3) = _____

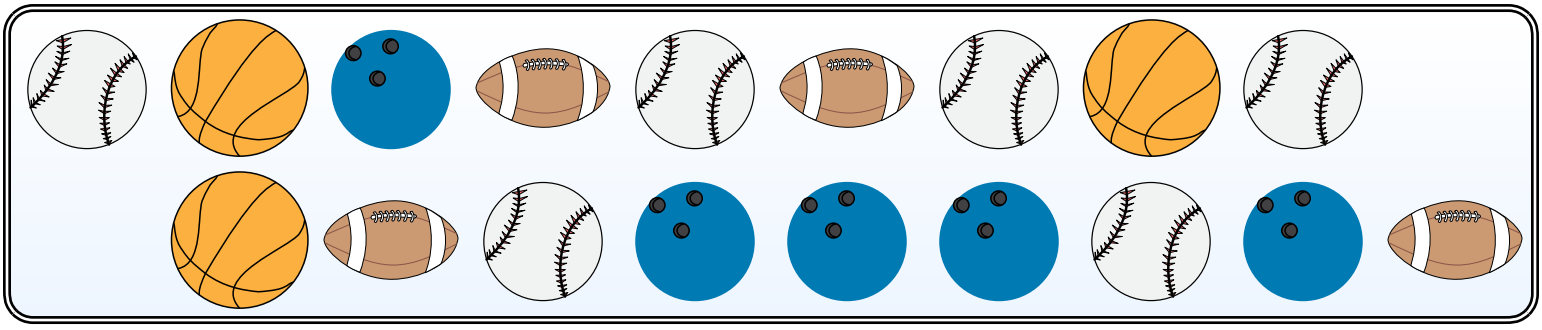

4) = _____

5) = _____

6) = _____

7) = _____



8) = _____

9) = _____

10) = _____

11) = _____

1-10	91	82	73	64	55	45	36	27	18	9
11	0									

Counting Figures

Name: **Answer Key**

Count the number of shapes in each box.



Ex) = 6

1) 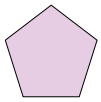 = 5

2) = 2

3) = 4

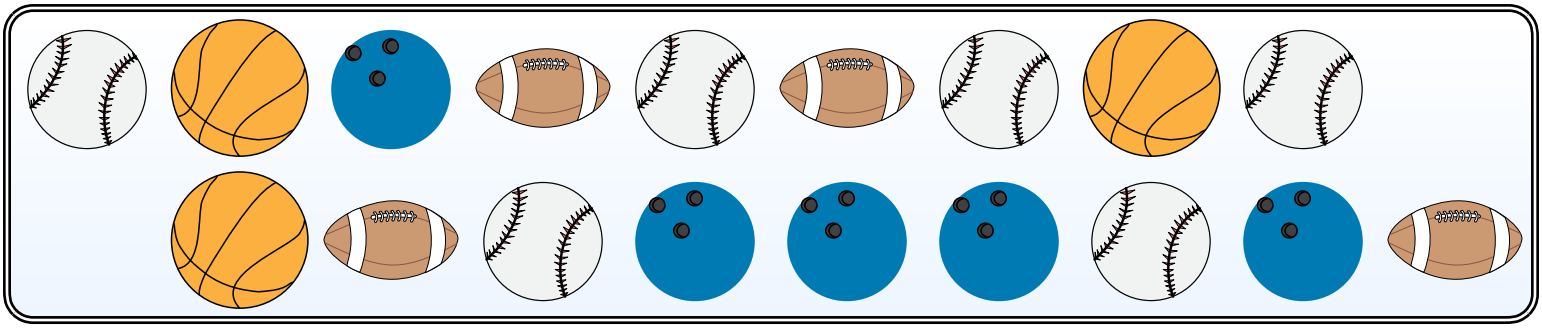

4) = 6

5) = 3

6) = 5

7) = 4



8) = 4

9) = 3

10) = 3

11) = 6

1-10	91	82	73	64	55	45	36	27	18	9
11	0									