# Finding Ratios (visual)

Name:

**Solve each problem.**

**Ex)** What is the ratio of pentagons to triangles?

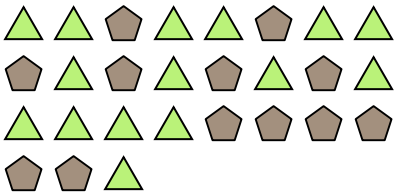

**1)** What is the ratio of circles to moons?



**2)** What is the ratio of stars to squares?

**3)** What is the ratio of moons to pentagons?

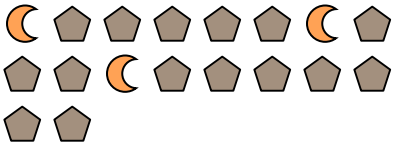

**4)** What is the ratio of hearts to moons?

**5)** What is the ratio of stars to triangles?

**6)** What is the ratio of moons to stars?

**7)** What is the ratio of pentagons to hearts?



**8)** What is the ratio of pentagons to stars?

**9)** What is the ratio of circles to moons?



**10)** What is the ratio of stars to moons?

**11)** What is the ratio of triangles to pentagons?

## Answers

Ex. 12:15

1. _____
2. _____
3. _____
4. _____
5. _____
6. _____
7. _____
8. _____
9. _____
10. _____
11. _____



| | | | | | | | | | | |
|---|---|---|---|---|---|---|---|---|---|---|
| 1-10 | 91 | 82 | 73 | 64 | 55 | 45 | 36 | 27 | 18 | 9 |
| 11 | 0 | | | | | | | | | |

Finding Ratios (visual) Name: **Answer Key**

**Solve each problem.**

**Ex)** What is the ratio of pentagons to triangles?

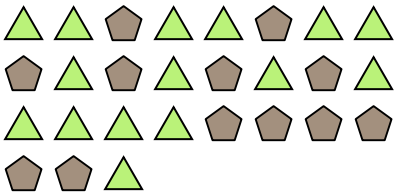

**1)** What is the ratio of circles to moons?



**2)** What is the ratio of stars to squares?

**3)** What is the ratio of moons to pentagons?

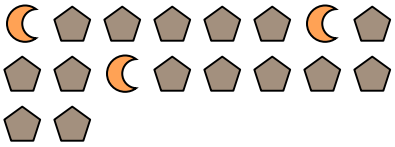

**4)** What is the ratio of hearts to moons?

**5)** What is the ratio of stars to triangles?

**6)** What is the ratio of moons to stars?

**7)** What is the ratio of pentagons to hearts?



**8)** What is the ratio of pentagons to stars?

**9)** What is the ratio of circles to moons?



**10)** What is the ratio of stars to moons?

**11)** What is the ratio of triangles to pentagons?

**Answers**

| | |
|---|---|
| Ex. | 12:15 |
| 1. | 11:11 |
| 2. | 7:9 |
| 3. | 3:15 |
| 4. | 9:2 |
| 5. | 4:11 |
| 6. | 12:8 |
| 7. | 8:10 |
| 8. | 11:2 |
| 9. | 15:11 |
| 10. | 4:5 |
| 11. | 11:3 |



| | | | | | | | | | | |
|---|---|---|---|---|---|---|---|---|---|---|
| 1-10 | 91 | 82 | 73 | 64 | 55 | 45 | 36 | 27 | 18 | 9 |
| 11 | 0 | | | | | | | | | |