Function Machines (Add & Subtract) Name:

Determine the rule each function machine is using.

Ex)

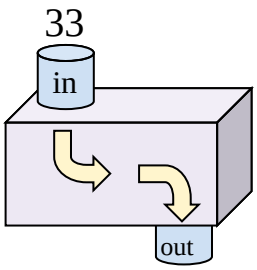

Subtract 5

1)

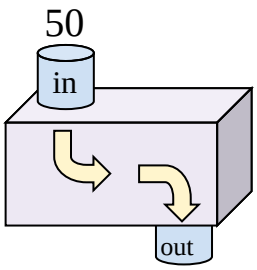

2)

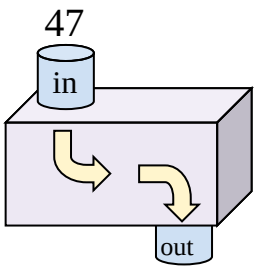

3)

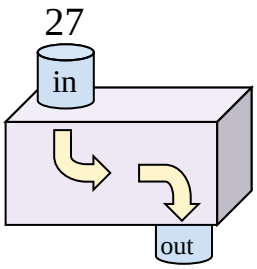

4)

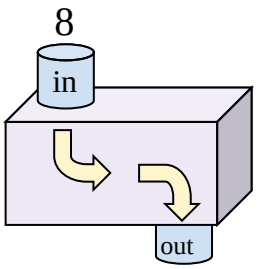

5)

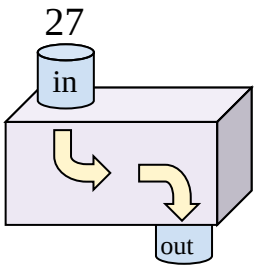

6)

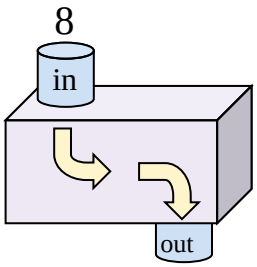

7)

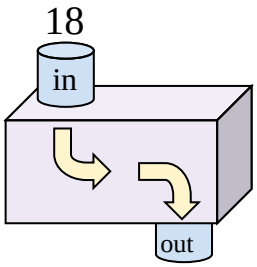

8)

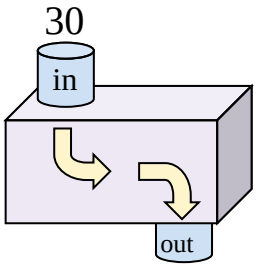

9)

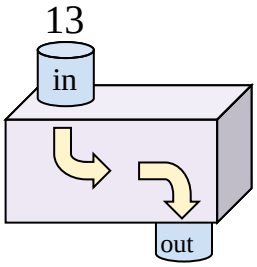

10)

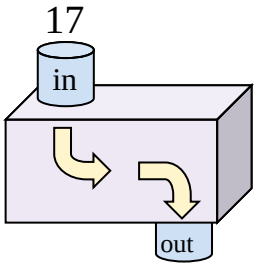

11)

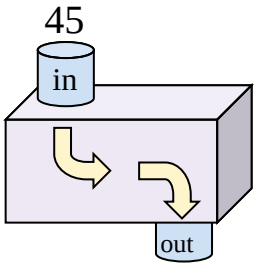

Answers

Ex. Subtract 5

1. _____
2. _____
3. _____
4. _____
5. _____
6. _____
7. _____
8. _____
9. _____
10. _____
11. _____

Function Machines (Add & Subtract) Name: **Answer Key**

Determine the rule each function machine is using.

Ex)

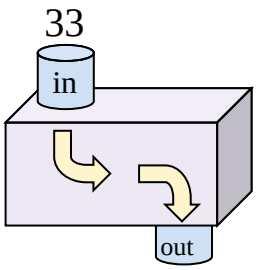

Subtract 5

1)

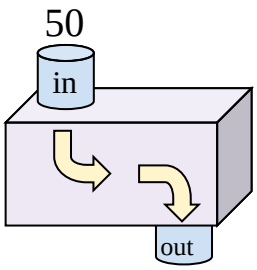

Subtract 36

2)

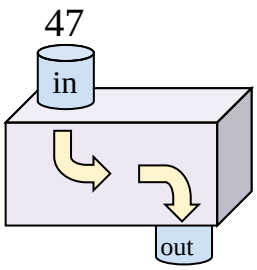

Subtract 41

3)

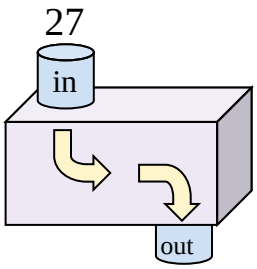

Subtract 16

4)

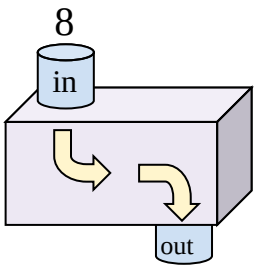

Add 6

5)

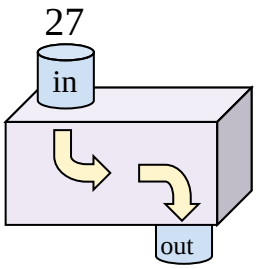

Add 7

6)

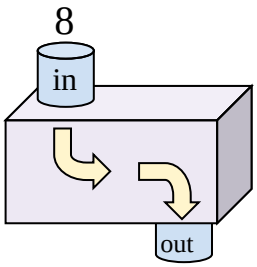

Add 7

7)

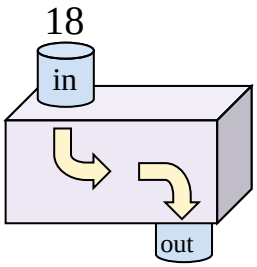

Add 22

8)

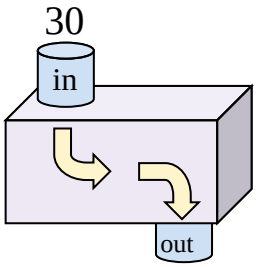

Add 12

9)

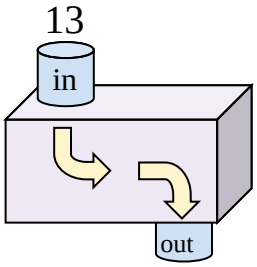

Add 12

10)

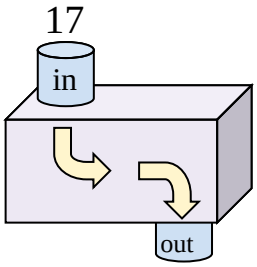

Add 32

11)

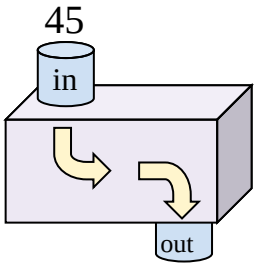

Subtract 22

Answers

Ex. Subtract 5

1. Subtract 36
2. Subtract 41
3. Subtract 16
4. Add 6
5. Add 7
6. Add 7
7. Add 22
8. Add 12
9. Add 12
10. Add 32
11. Subtract 22