Function Machines (Add & Subtract) Name:

Determine the rule each function machine is using.

Ex)

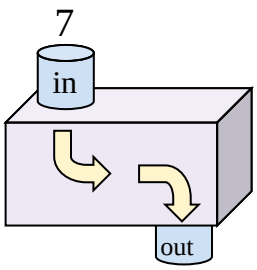

Add 13

1)

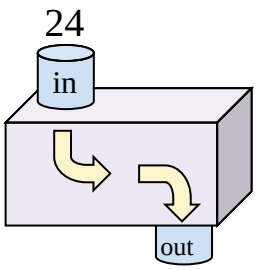

2)

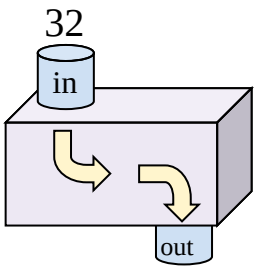

3)

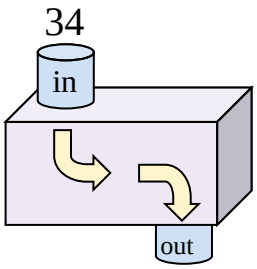

4)

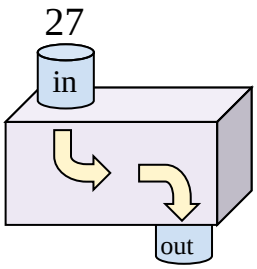

5)

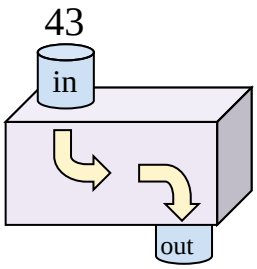

6)

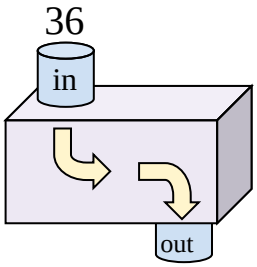

7)

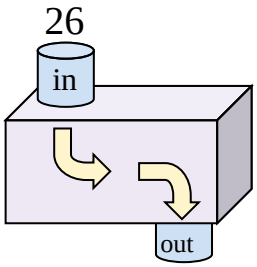

8)

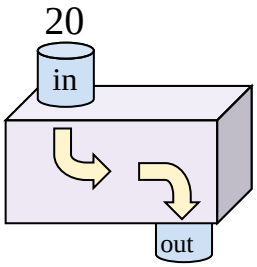

9)

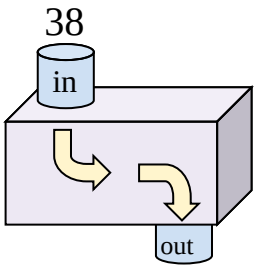

10)

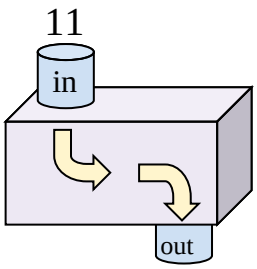

11)

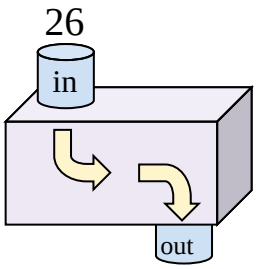

Answers

Ex. Add 13

1. _____
2. _____
3. _____
4. _____
5. _____
6. _____
7. _____
8. _____
9. _____
10. _____
11. _____

1-10	91	82	73	64	55	45	36	27	18	9
11	0									

Function Machines (Add & Subtract) Name: **Answer Key**

Determine the rule each function machine is using.

Ex)

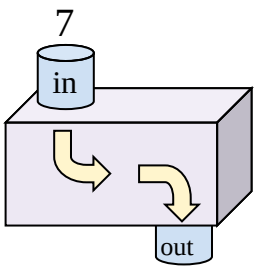

Add 13

1)

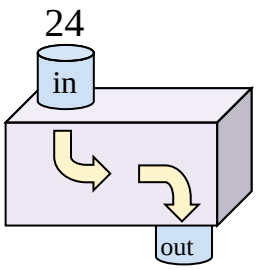

Add 9

2)

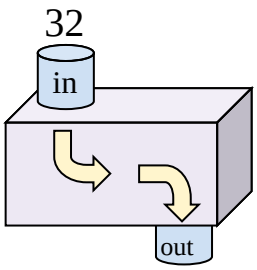

Subtract 23

3)

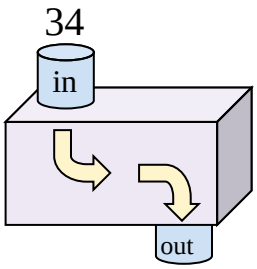

Subtract 5

4)

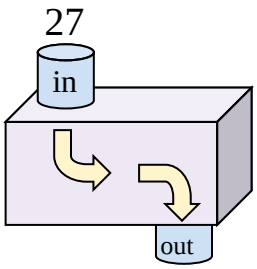

Add 10

5)

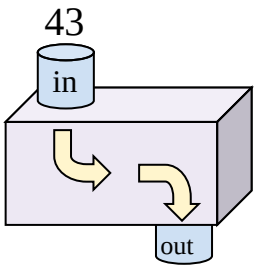

Subtract 17

6)

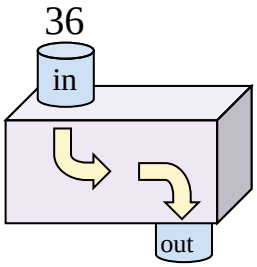

Subtract 16

7)

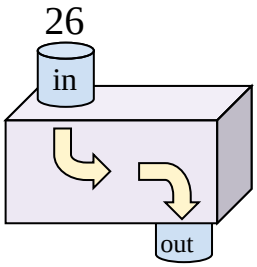

Add 5

8)

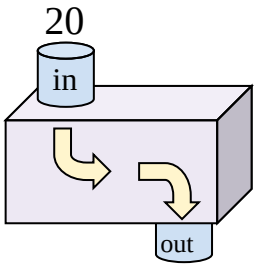

Add 13

9)

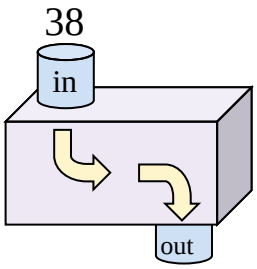

Subtract 26

10)

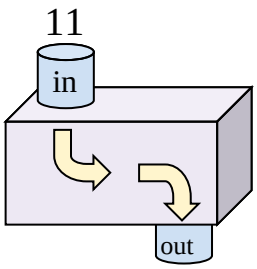

Add 8

11)

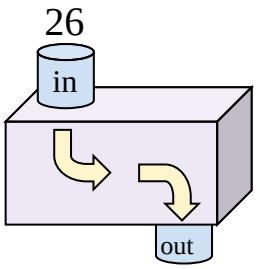

Subtract 16

Answers

Ex.	Add 13
1.	Add 9
2.	Subtract 23
3.	Subtract 5
4.	Add 10
5.	Subtract 17
6.	Subtract 16
7.	Add 5
8.	Add 13
9.	Subtract 26
10.	Add 8
11.	Subtract 16

1-10	91	82	73	64	55	45	36	27	18	9
11	0									