Function Machines (Add & Subtract) Name:

Determine the rule each function machine is using.

Ex)

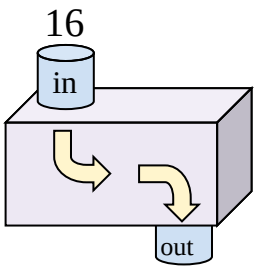

Add 12

1)

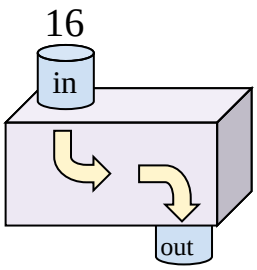

2)

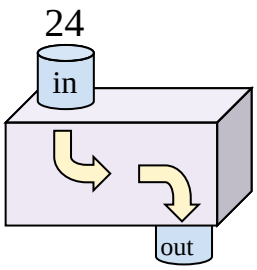

3)

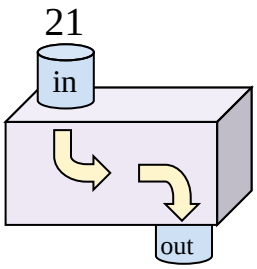

4)

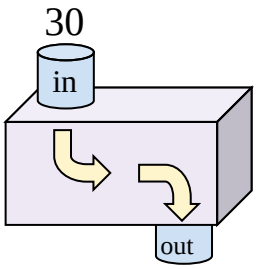

5)

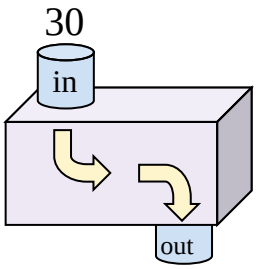

6)

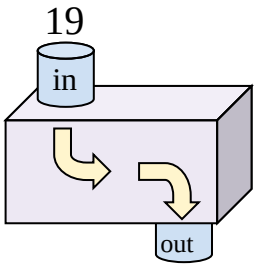

7)

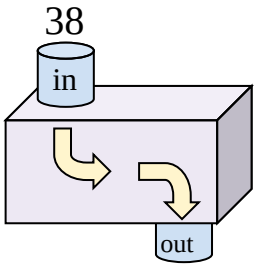

8)

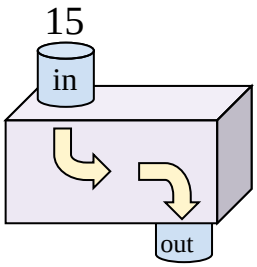

9)

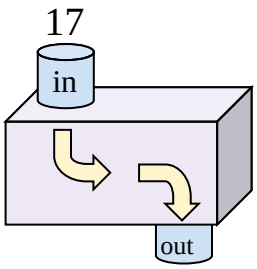

10)

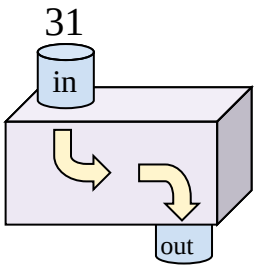

11)

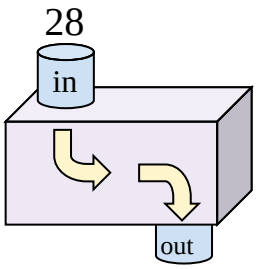

Answers

Ex. **Add 12**

1. _____
2. _____
3. _____
4. _____
5. _____
6. _____
7. _____
8. _____
9. _____
10. _____
11. _____

1-10	91	82	73	64	55	45	36	27	18	9
11	0									

Function Machines (Add & Subtract) Name: **Answer Key**

Determine the rule each function machine is using.

Ex)

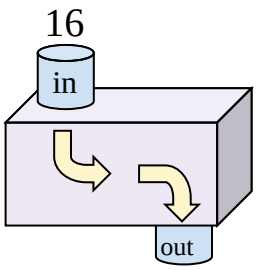

Add 12

1)

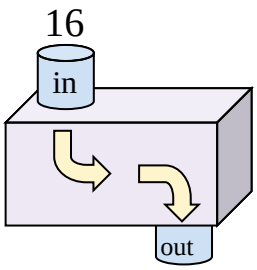

Add 6

2)

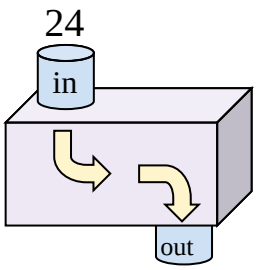

Subtract 17

3)

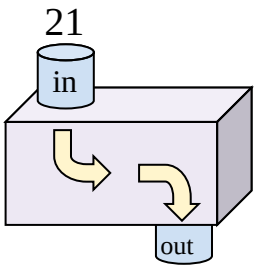

Add 14

4)

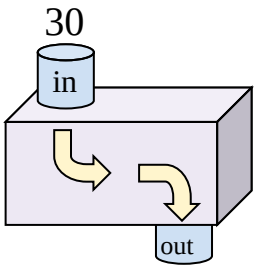

Subtract 17

5)

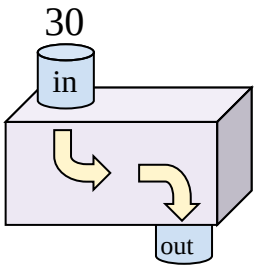

Subtract 7

6)

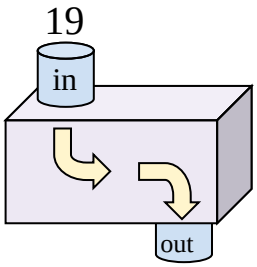

Add 13

7)

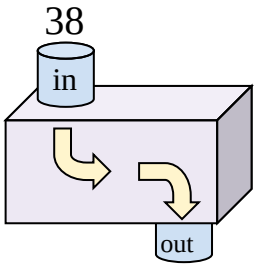

Subtract 17

8)

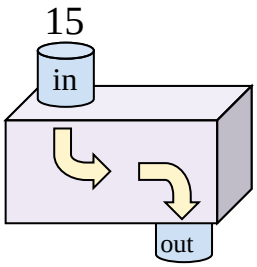

Add 8

9)

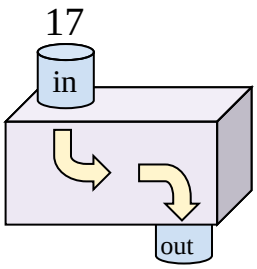

Add 15

10)

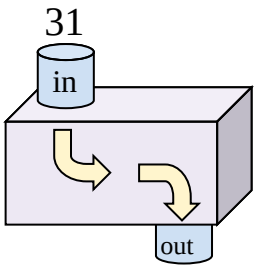

Subtract 24

11)

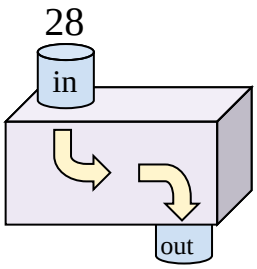

Subtract 18

Answers

Ex.	Add 12
1.	Add 6
2.	Subtract 17
3.	Add 14
4.	Subtract 17
5.	Subtract 7
6.	Add 13
7.	Subtract 17
8.	Add 8
9.	Add 15
10.	Subtract 24
11.	Subtract 18

1-10	91	82	73	64	55	45	36	27	18	9
11	0									