Rewriting Multiplication Problems (visual)

Name:

Write each array as a multiplication problem and solve.

Ex)

1)

2)



3)

4)



5)

6)

7)

8)

9)

10)

11)

Answers

Ex. **5 × 8 = 40**

1. _____
2. _____
3. _____
4. _____
5. _____
6. _____
7. _____
8. _____
9. _____
10. _____
11. _____

1-10	91	82	73	64	55	45	36	27	18	9
11	0									

Rewriting Multiplication Problems (visual) Name: **Answer Key**

Write each array as a multiplication problem and solve.

Ex)

1)

2) 

3)

4) 

5)

6)

7)

8)

9)

10)

11) 

Answers

Ex.	5 × 8 = 40
1.	10 × 5 = 50
2.	4 × 5 = 20
3.	2 × 8 = 16
4.	3 × 9 = 27
5.	7 × 2 = 14
6.	4 × 4 = 16
7.	2 × 2 = 4
8.	8 × 2 = 16
9.	7 × 3 = 21
10.	4 × 2 = 8
11.	10 × 2 = 20

1-10	91	82	73	64	55	45	36	27	18	9
11	0									