Creating Rectangles with a Coordinate Grid Name:

Find the coordinates of point D to make a rectangle.

Ex)

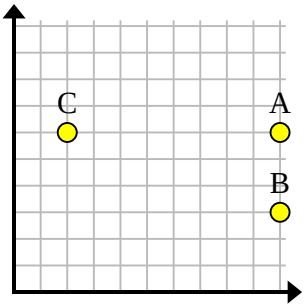

1)

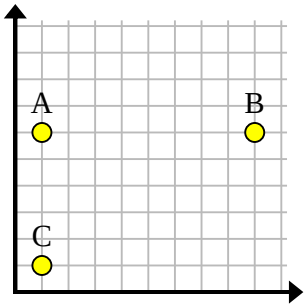

2)

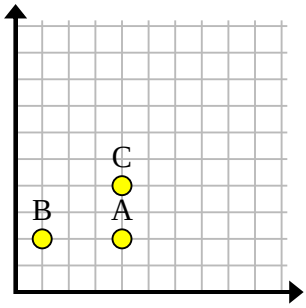

3)

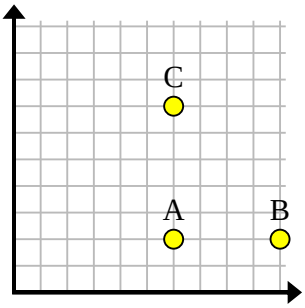

4)

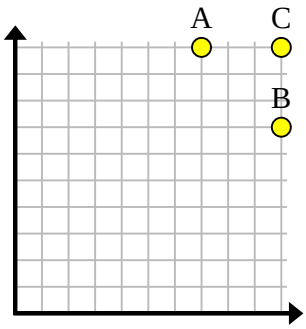

5)

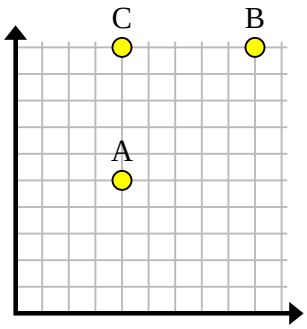

6)

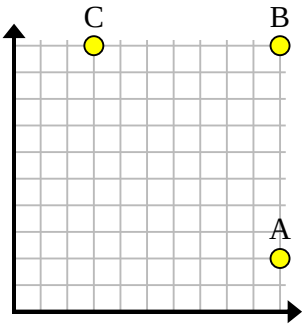

7)

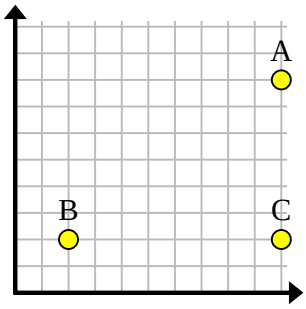

8)

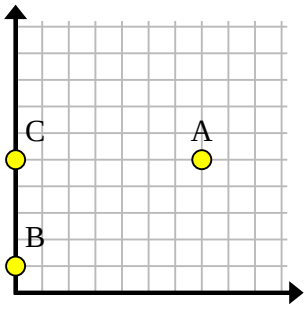

9)

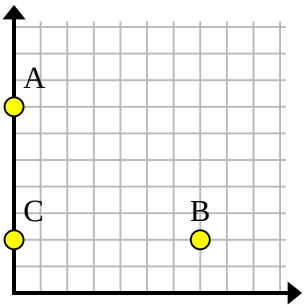

10)

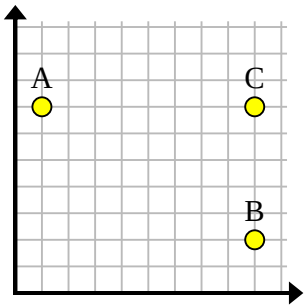

11)

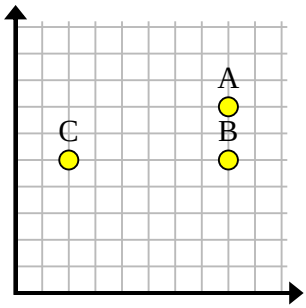

Answers

Ex. (2 , 3)

1. _____

2. _____

3. _____

4. _____

5. _____

6. _____

7. _____

8. _____

9. _____

10. _____

11. _____

1-10	91	82	73	64	55	45	36	27	18	9
11	0									

Creating Rectangles with a Coordinate Grid Name: **Answer Key**

Find the coordinates of point D to make a rectangle.

Ex)

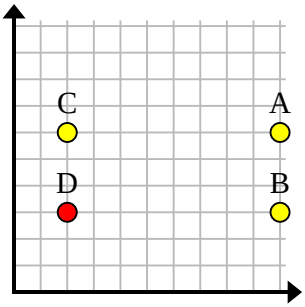

1)

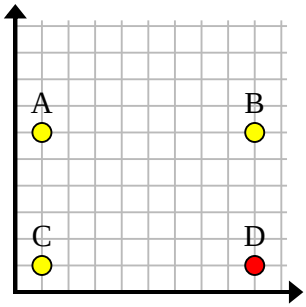

2)

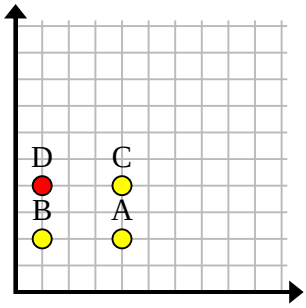

3)

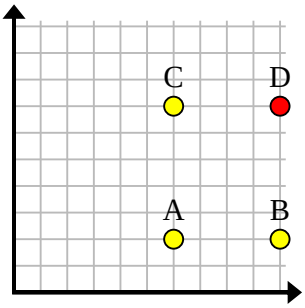

4)

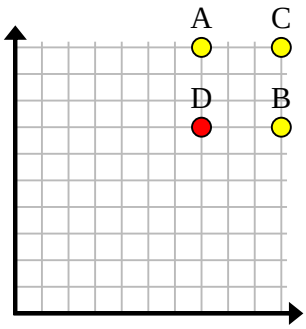

5)

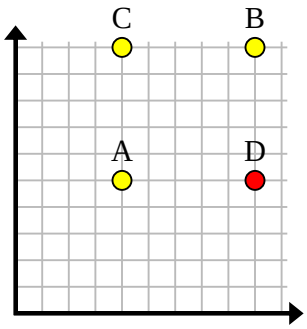

6)

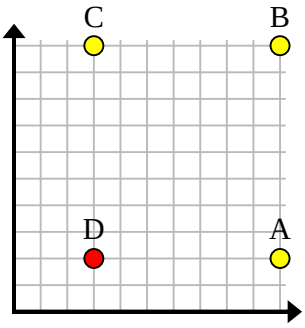

7)

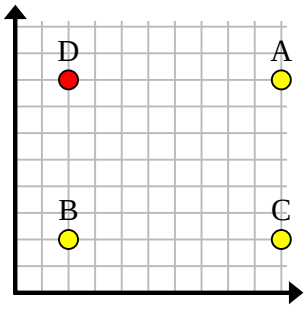

8)

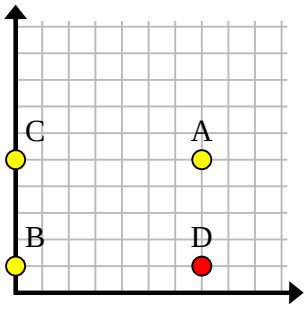

9)

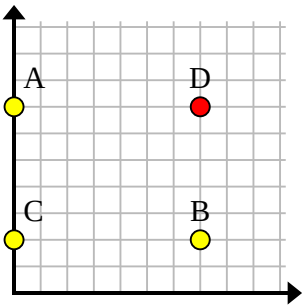

10)

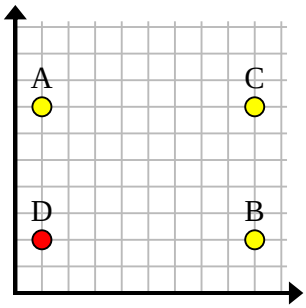

11)

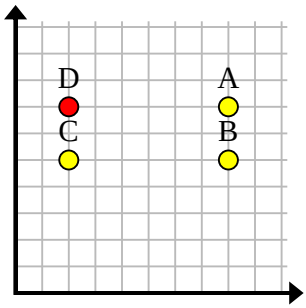

Answers

Ex.	(2, 3)
1.	(9, 1)
2.	(1, 4)
3.	(10, 7)
4.	(7, 7)
5.	(9, 5)
6.	(3, 2)
7.	(2, 8)
8.	(7, 1)
9.	(7, 7)
10.	(1, 2)
11.	(2, 7)

1-10	91	82	73	64	55	45	36	27	18	9
11	0									