Multiplying Fractions (Visual)

Name:

Use the box provided to show a visual example of how to multiply two fractions.

Ex) $\frac{1}{2} \times \frac{1}{6} =$

1) $\frac{3}{5} \times \frac{4}{7} =$

2) $\frac{1}{5} \times \frac{1}{3} =$

3) $\frac{1}{5} \times \frac{2}{5} =$

4) $\frac{2}{8} \times \frac{4}{5} =$

5) $\frac{3}{5} \times \frac{6}{9} =$

6) $\frac{1}{6} \times \frac{2}{4} =$

7) $\frac{4}{5} \times \frac{3}{7} =$

8) $\frac{4}{5} \times \frac{4}{6} =$

9) $\frac{2}{3} \times \frac{1}{5} =$

10) $\frac{4}{6} \times \frac{1}{9} =$

11) $\frac{3}{5} \times \frac{3}{7} =$

Answers

Ex. $\frac{1}{12}$

1. _____
2. _____
3. _____
4. _____
5. _____
6. _____
7. _____
8. _____
9. _____
10. _____
11. _____

1-10	91	82	73	64	55	45	36	27	18	9
11	0									

Multiplying Fractions (Visual) Name: **Answer Key**

Use the box provided to show a visual example of how to multiply two fractions.

Ex) $\frac{1}{2} \times \frac{1}{6} =$

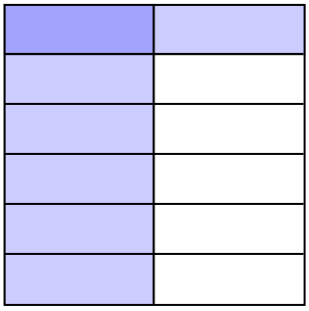

1) $\frac{3}{5} \times \frac{4}{7} =$

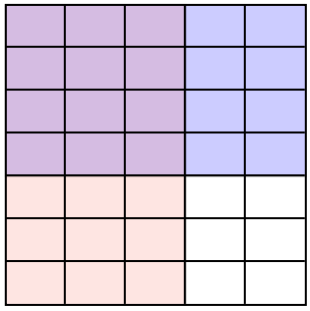

2) $\frac{1}{5} \times \frac{1}{3} =$

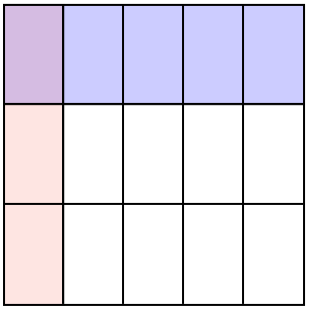

3) $\frac{1}{5} \times \frac{2}{5} =$

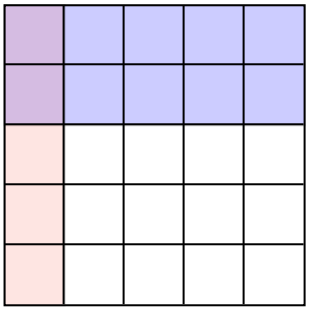

4) $\frac{2}{8} \times \frac{4}{5} =$

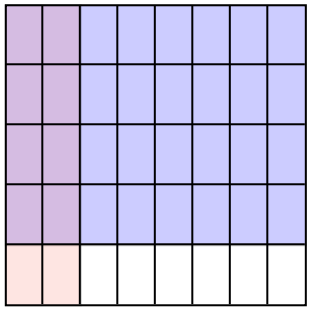

5) $\frac{3}{5} \times \frac{6}{9} =$

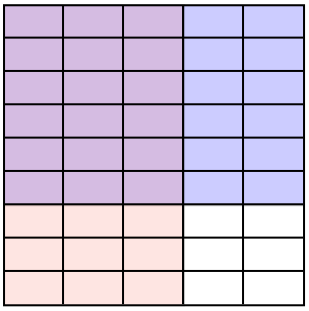

6) $\frac{1}{6} \times \frac{2}{4} =$

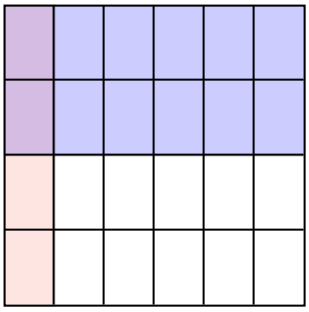

7) $\frac{4}{5} \times \frac{3}{7} =$

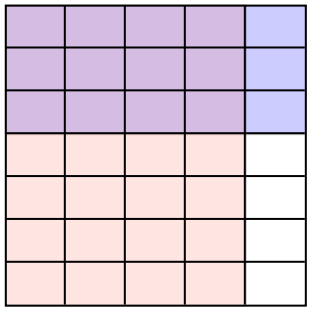

8) $\frac{4}{5} \times \frac{4}{6} =$

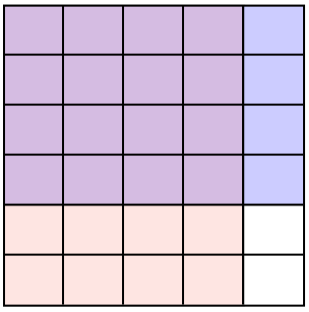

9) $\frac{2}{3} \times \frac{1}{5} =$



10) $\frac{4}{6} \times \frac{1}{9} =$

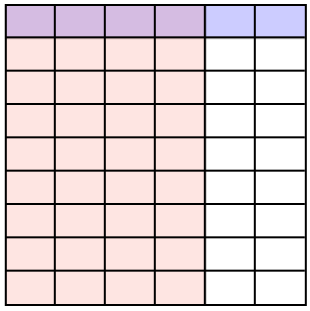

11) $\frac{3}{5} \times \frac{3}{7} =$

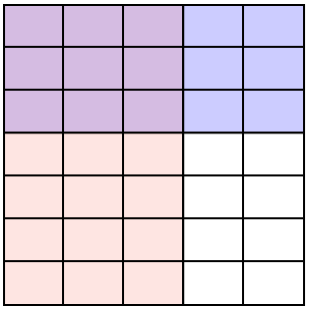

Answers

Ex. $\frac{1}{12}$

1. $\frac{12}{35}$
2. $\frac{1}{15}$
3. $\frac{2}{25}$
4. $\frac{8}{40}$
5. $\frac{18}{45}$
6. $\frac{2}{24}$
7. $\frac{12}{35}$
8. $\frac{16}{30}$
9. $\frac{2}{15}$
10. $\frac{4}{54}$
11. $\frac{9}{35}$

1-10	91	82	73	64	55	45	36	27	18	9
11	0									