Fraction, Decimal & Percent (Visual)

Name:

Determine the value written as a fraction , decimal & a percent.

Ex)

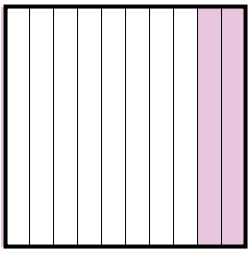

fraction $\frac{3}{10}$
decimal 0.3
percent 30

1)

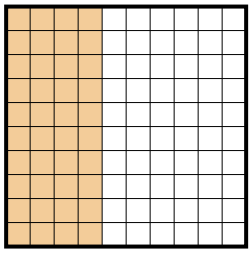

fraction
decimal
percent

2)

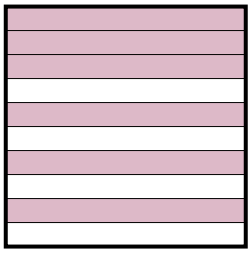

fraction
decimal
percent

3)

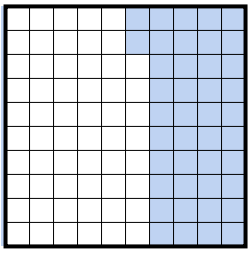

fraction
decimal
percent

4)

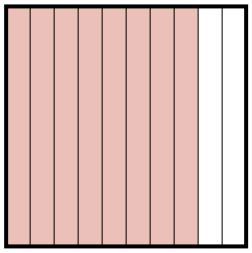

fraction
decimal
percent

5)

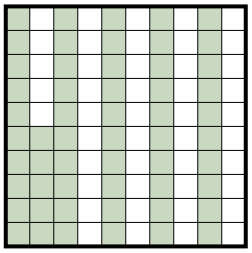

fraction
decimal
percent

6)

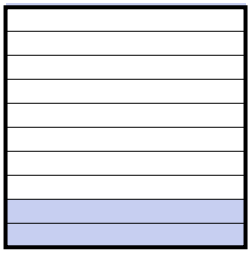

fraction
decimal
percent

7)

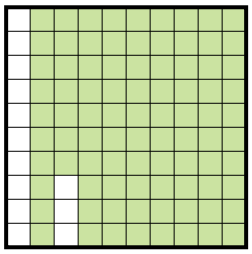

fraction
decimal
percent

8)



fraction
decimal
percent

9)

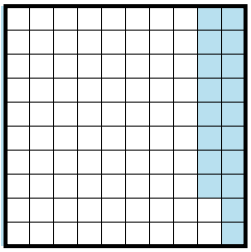

fraction
decimal
percent

10)

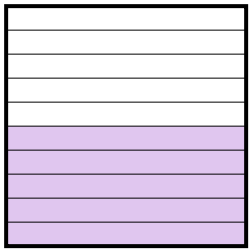

fraction
decimal
percent

11)

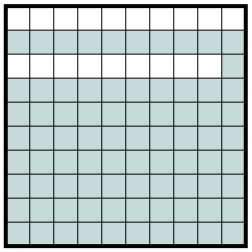

fraction
decimal
percent

Answers

Ex.	$\frac{3}{10}$	0.3	30%
1.			
2.			
3.			
4.			
5.			
6.			
7.			
8.			
9.			
10.			
11.			

Fraction, Decimal & Percent (Visual) Name: **Answer Key**

Determine the value written as a fraction , decimal & a percent.

Ex)

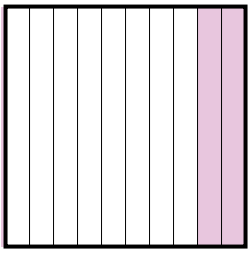

fraction $\frac{3}{10}$
decimal 0.3
percent 30

1)

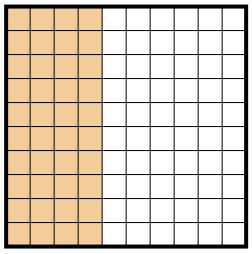

fraction $\frac{40}{100}$
decimal 0.40
percent 40

2)

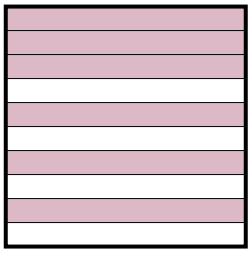

fraction $\frac{6}{10}$
decimal 0.6
percent 60

3)

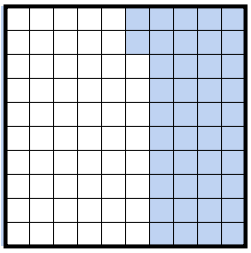

fraction $\frac{72}{100}$
decimal 0.72
percent 72

4)

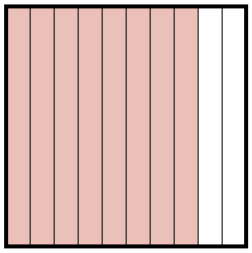

fraction $\frac{8}{10}$
decimal 0.8
percent 80

5)

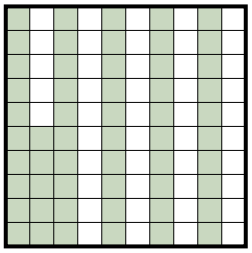

fraction $\frac{55}{100}$
decimal 0.55
percent 55

6)

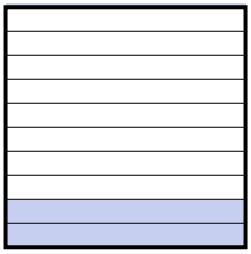

fraction $\frac{4}{10}$
decimal 0.4
percent 40

7)

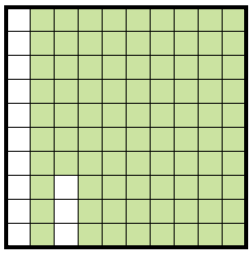

fraction $\frac{87}{100}$
decimal 0.87
percent 87

8)



fraction $\frac{2}{10}$
decimal 0.2
percent 20

9)

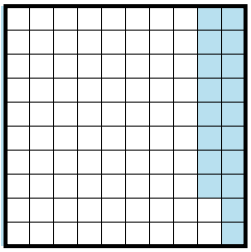

fraction $\frac{28}{100}$
decimal 0.28
percent 28

10)

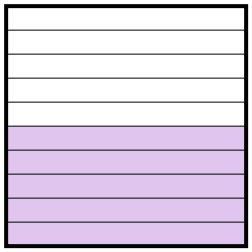

fraction $\frac{5}{10}$
decimal 0.5
percent 50

11)

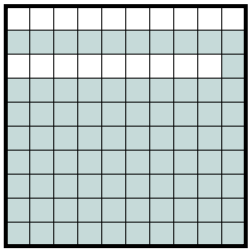

fraction $\frac{81}{100}$
decimal 0.81
percent 81

Answers

Ex.	$\frac{3}{10}$	0.3	30%
1.	$\frac{40}{100}$	0.40	40%
2.	$\frac{6}{10}$	0.6	60%
3.	$\frac{72}{100}$	0.72	72%
4.	$\frac{8}{10}$	0.8	80%
5.	$\frac{55}{100}$	0.55	55%
6.	$\frac{4}{10}$	0.4	40%
7.	$\frac{87}{100}$	0.87	87%
8.	$\frac{2}{10}$	0.2	20%
9.	$\frac{28}{100}$	0.28	28%
10.	$\frac{5}{10}$	0.5	50%
11.	$\frac{81}{100}$	0.81	81%