Dividing with a Numberline

Name:

Use the numberline to solve each problem.

1) 35÷7=

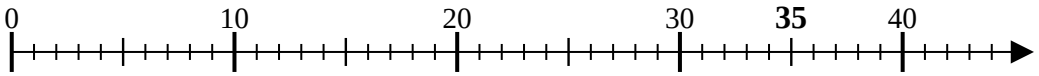

2) 6÷2=

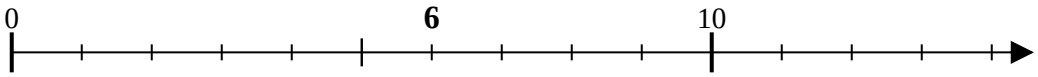

3) 30÷6=

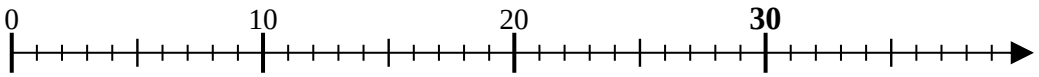

4) 40÷8=

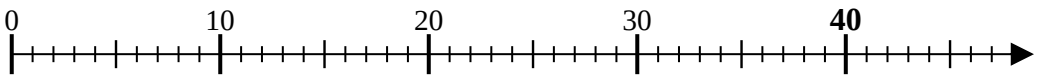

5) 16÷8=

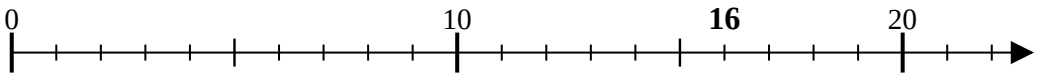

6) 15÷3=

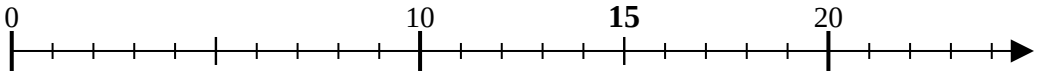

7) 12÷6=

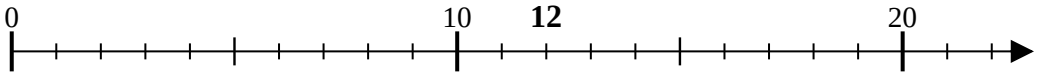

8) 20÷4=

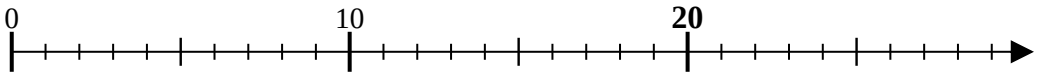

9) 6÷3=

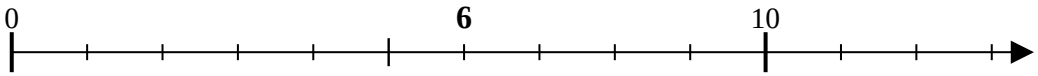

10) 24÷6=

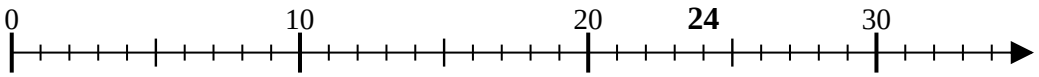

11) 8÷4=

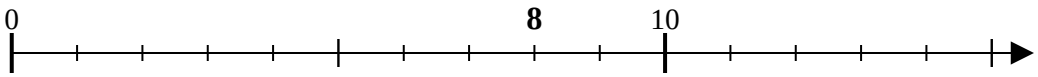

Answers

1. _____
2. _____
3. _____
4. _____
5. _____
6. _____
7. _____
8. _____
9. _____
10. _____
11. _____

1-10	91	82	73	64	55	45	36	27	18	9
11	0									

Dividing with a Numberline

Name: **Answer Key**

Use the numberline to solve each problem.

1) 35÷7=

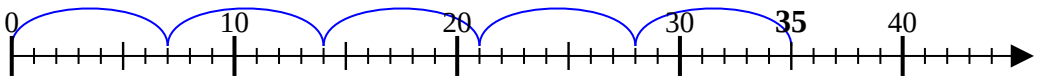

2) 6÷2=

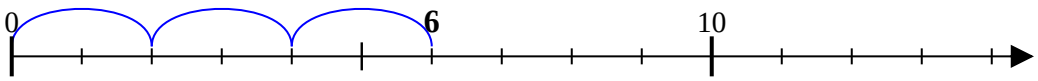

3) 30÷6=

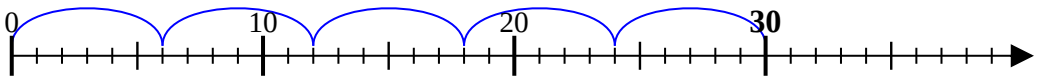

4) 40÷8=

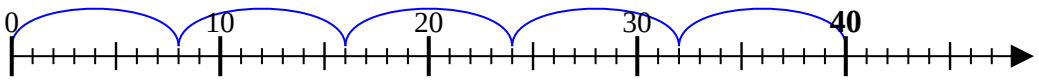

5) 16÷8=

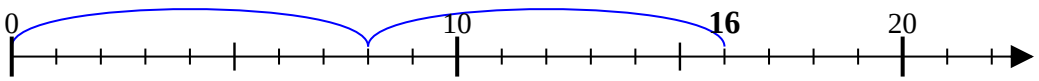

6) 15÷3=

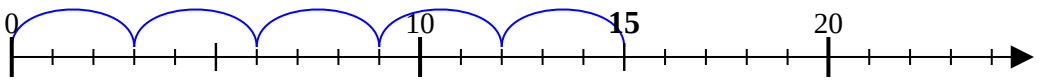

7) 12÷6=

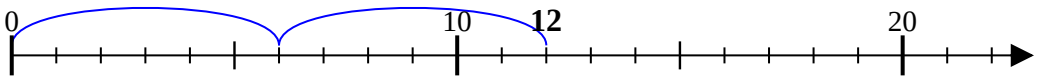

8) 20÷4=

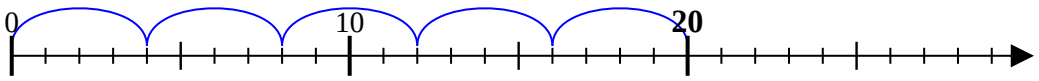

9) 6÷3=

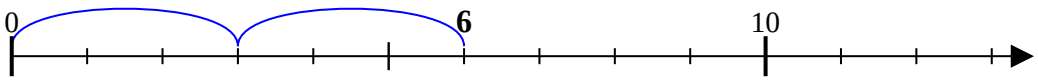

10) 24÷6=

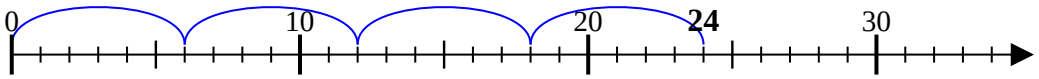

11) 8÷4=

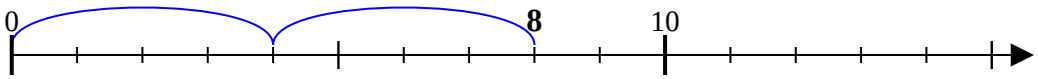

Answers

1. 5
2. 3
3. 5
4. 5
5. 2
6. 5
7. 2
8. 5
9. 2
10. 4
11. 2