Dividing with a Numberline Name:

Use the numberline to solve each problem.

1) 50÷10=

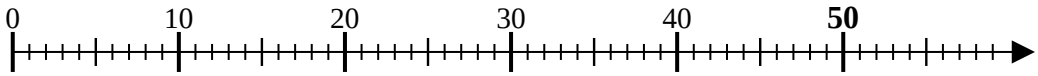

2) 16÷4=

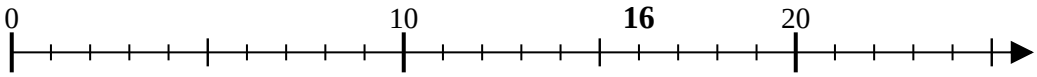

3) 14÷7=

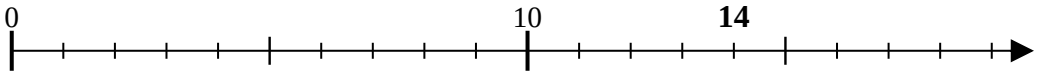

4) 28÷7=

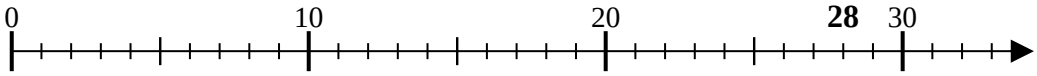

5) 20÷4=

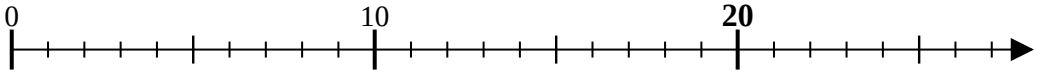

6) 45÷9=

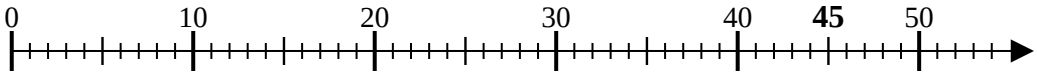

7) 20÷10=

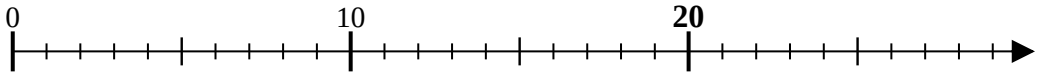

8) 16÷8=

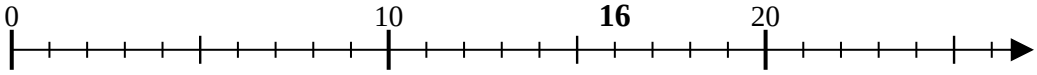

9) 12÷4=

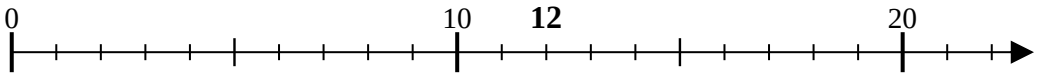

10) 4÷2=

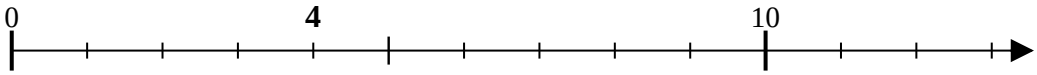

11) 36÷9=

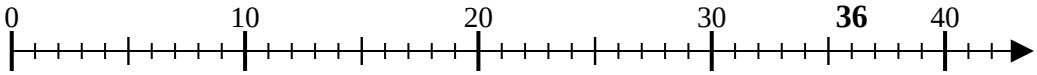

Answers

1. _____
2. _____
3. _____
4. _____
5. _____
6. _____
7. _____
8. _____
9. _____
10. _____
11. _____

1-10	91	82	73	64	55	45	36	27	18	9
11	0									

Dividing with a Numberline

Name: **Answer Key**

Use the numberline to solve each problem.

1) 50÷10=

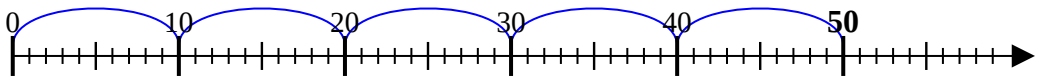

2) 16÷4=

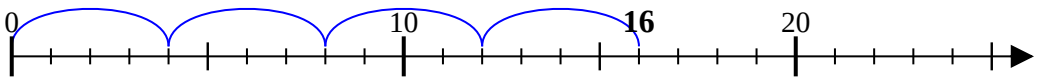

3) 14÷7=

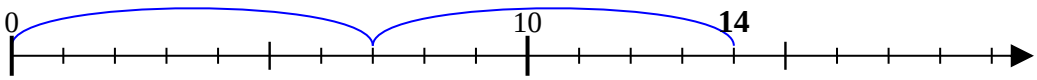

4) 28÷7=

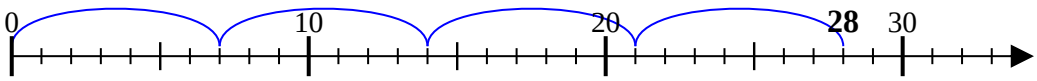

5) 20÷4=

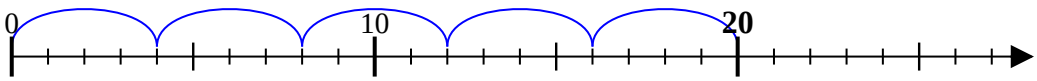

6) 45÷9=

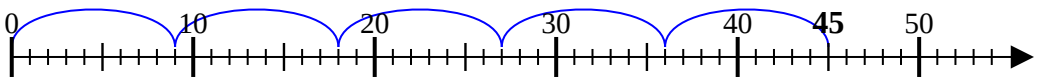

7) 20÷10=

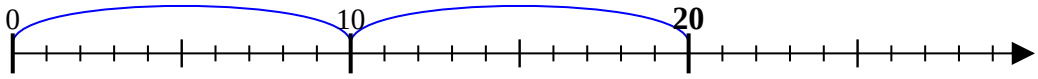

8) 16÷8=

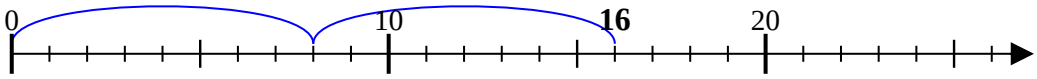

9) 12÷4=

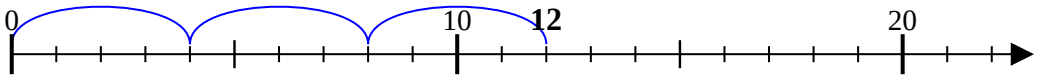

10) 4÷2=

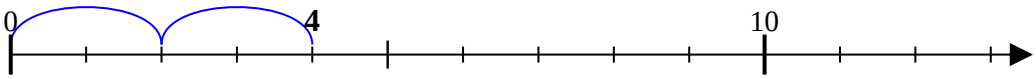

11) 36÷9=

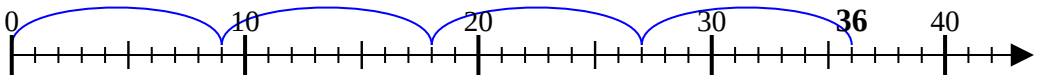

Answers

1. 5
2. 4
3. 2
4. 4
5. 5
6. 5
7. 2
8. 2
9. 3
10. 2
11. 4

1-10	91	82	73	64	55	45	36	27	18	9
11	0									