Dividing with a Numberline

Name:

Use the numberline to solve each problem.

1) 10÷2=

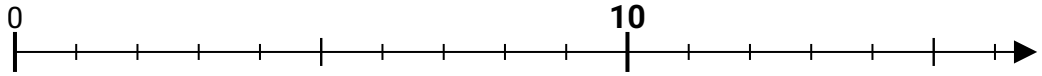

2) 4÷2=

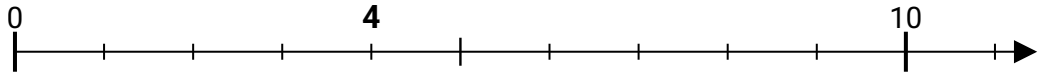

3) 27÷9=

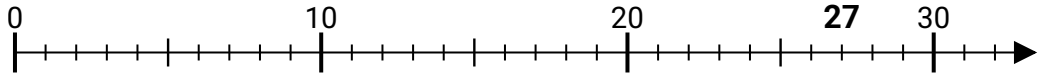

4) 40÷8=

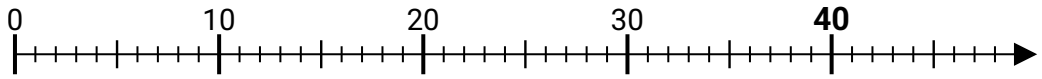

5) 18÷9=

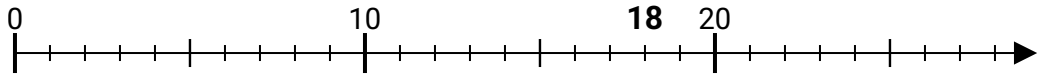

6) 8÷4=

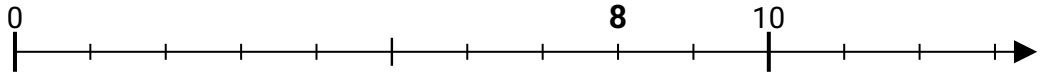

7) 20÷5=

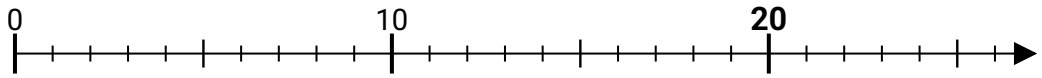

8) 32÷8=

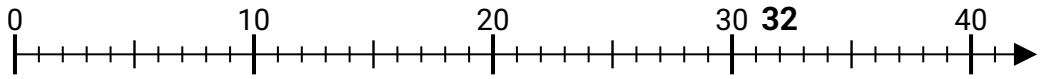

9) 16÷4=

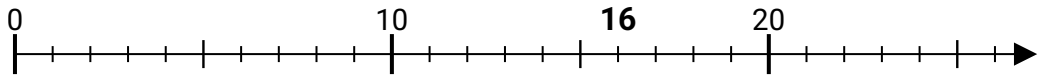

10) 40÷10=

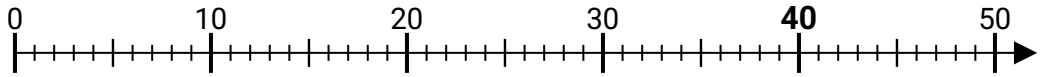

11) 9÷3=

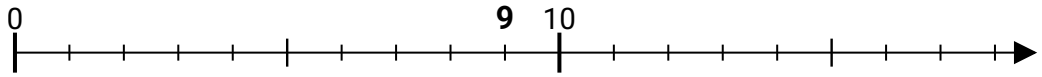

Answers

1. _____
2. _____
3. _____
4. _____
5. _____
6. _____
7. _____
8. _____
9. _____
10. _____
11. _____

1-10	91	82	73	64	55	45	36	27	18	9
11	0									

Dividing with a Numberline

Name: **Answer Key**

Use the numberline to solve each problem.

1) 10÷2=

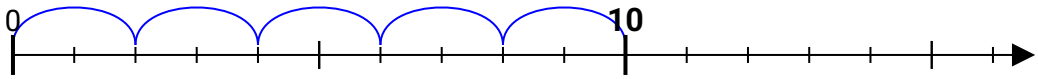

2) 4÷2=

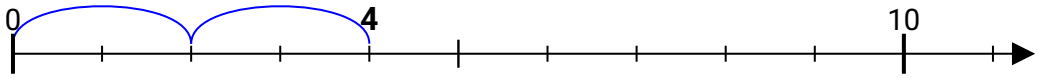

3) 27÷9=

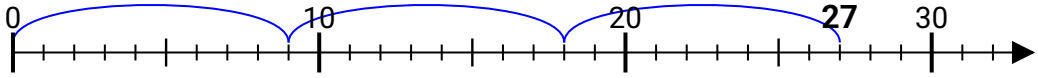

4) 40÷8=

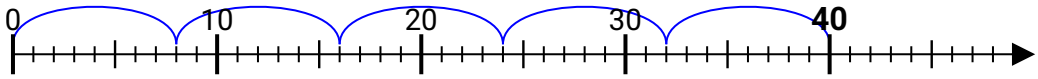

5) 18÷9=

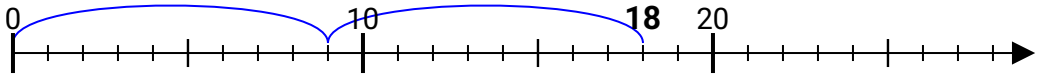

6) 8÷4=

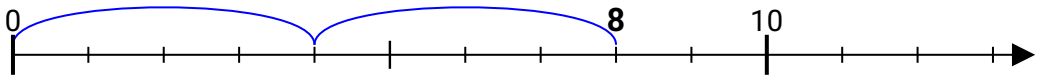

7) 20÷5=

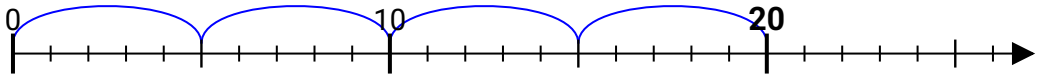

8) 32÷8=

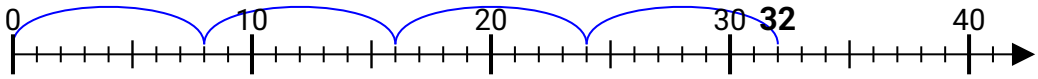

9) 16÷4=

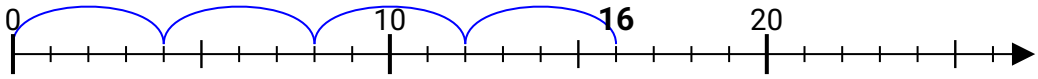

10) 40÷10=

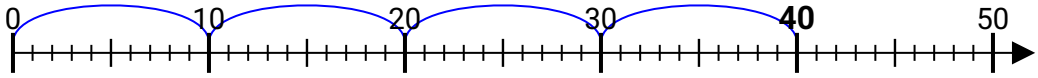

11) 9÷3=

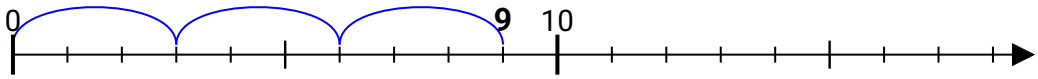

Answers

1. 5
2. 2
3. 3
4. 5
5. 2
6. 2
7. 4
8. 4
9. 4
10. 4
11. 3