Completing and Matching Volume Equations

Name:

Match each problem with the equation that could represent it. Answer with the missing term and letter.

Ex)

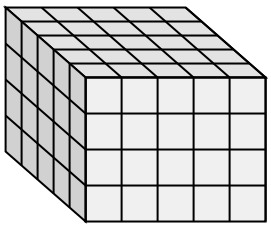

1)

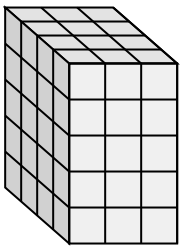

2)

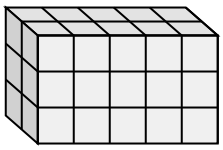

3)

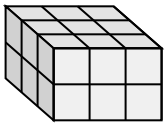

4)

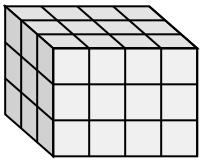

5)

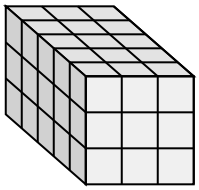

6)

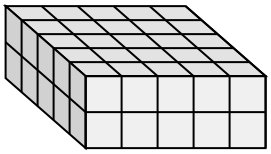

7)

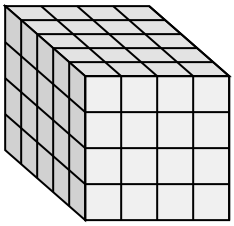

8)

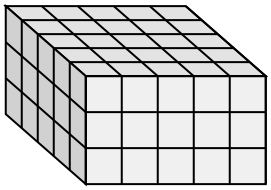

9)

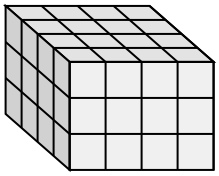

10)

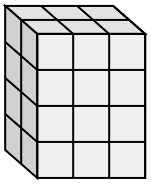

11)

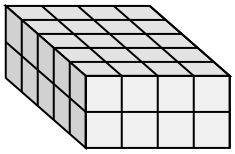

A. 3 × ___ × 2 = 18

B. 4 × 4 × ___ = 48

C. 5 × 5 × ___ = 75

D. 5 × 4 × ___ = 40

E. 4 × ___ × 5 = 60

F. ___ × 5 × 2 = 50

G. ___ × 5 × 3 = 30

H. 5 × 3 × ___ = 45

I. ___ × 4 × 3 = 36

J. ___ × 5 × 4 = 100

K. ___ × 4 × 4 = 80

L. ___ × 3 × 4 = 24

Answers

Ex. J , 5

1. _____
2. _____
3. _____
4. _____
5. _____
6. _____
7. _____
8. _____
9. _____
10. _____
11. _____

Completing and Matching Volume Equations Name: **Answer Key**

Match each problem with the equation that could represent it. Answer with the missing term and letter.

Ex)

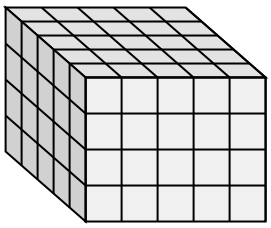

1)

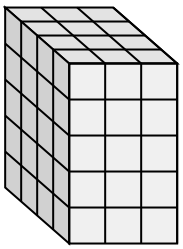

2)

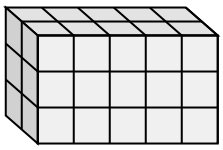

3)

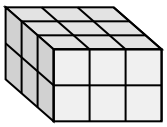

4)

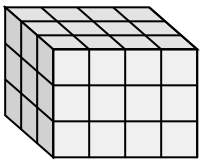

5)

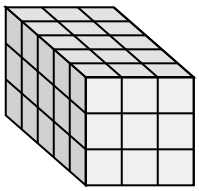

6)

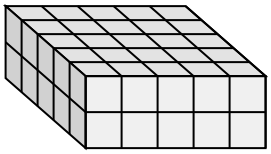

7)

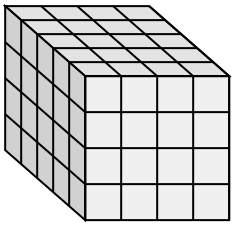

8)

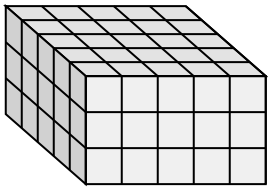

9)

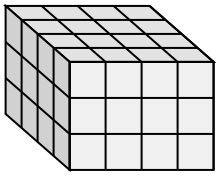

10)

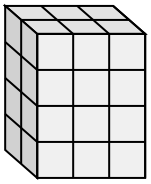

11)

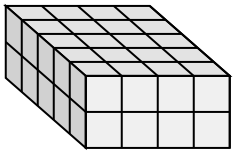

A. 3 × ___ × 2 = 18

B. 4 × 4 × ___ = 48

C. 5 × 5 × ___ = 75

D. 5 × 4 × ___ = 40

E. 4 × ___ × 5 = 60

F. ___ × 5 × 2 = 50

G. ___ × 5 × 3 = 30

H. 5 × 3 × ___ = 45

I. ___ × 4 × 3 = 36

J. ___ × 5 × 4 = 100

K. ___ × 4 × 4 = 80

L. ___ × 3 × 4 = 24

Answers

Ex. J , 5

1. E , 3
2. G , 2
3. A , 3
4. I , 3
5. H , 3
6. F , 5
7. K , 5
8. C , 3
9. B , 3
10. L , 2
11. D , 2